1. Укажите номер рисунка, на котором представлен эскиз графика функции $y = 2 - (x - 3)^2$.

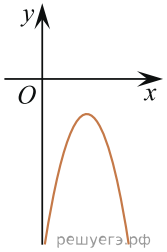

1)

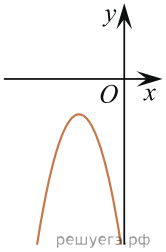

2)

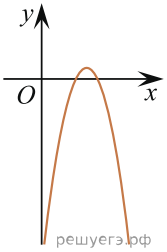

3)

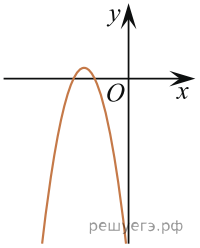

4)

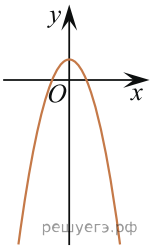

5)

1) 1 2) 2 3) 3 4) 4 5) 5

2. Укажите номер рисунка, на котором представлен эскиз графика функции $y = 1 - (x - 2)^2$.

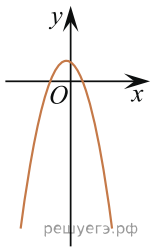

1)

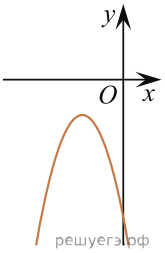

2)

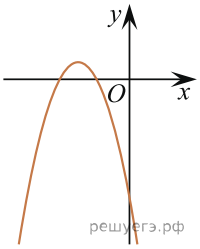

3)

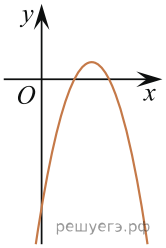

4)

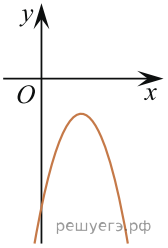

5)

1) 1 2) 2 3) 3 4) 4 5) 5

3. Укажите номер рисунка, на котором представлен эскиз графика функции $y = 1 - (x - 3)^2$.

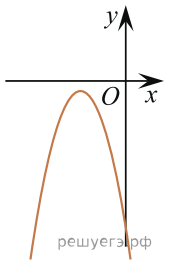

1)

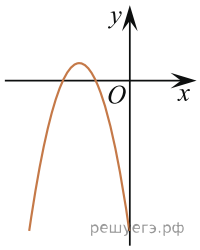

2)

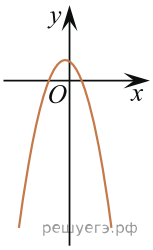

3)

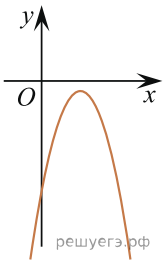

4)

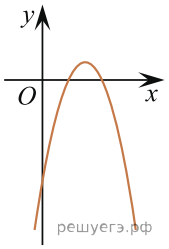

5)

1) 1 2) 2 3) 3 4) 4 5) 5

4. Укажите номер рисунка, на котором представлен эскиз графика функции $y = 4 - (x + 1)^2$.

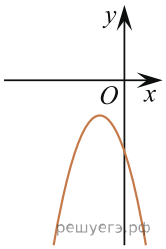

1)

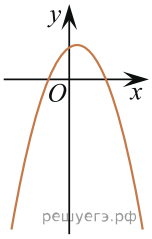

2)

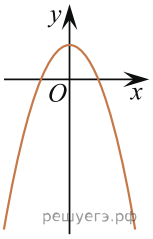

3)

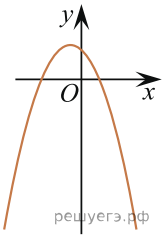

4)

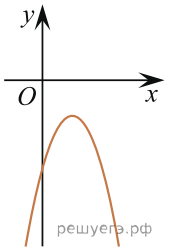

5)

1) 1 2) 2 3) 3 4) 4 5) 5